54. Write the beats to the following measures of music. The first measure has been done for you.

55. Music notes move up, down, or stay the same.

These notes move UP:

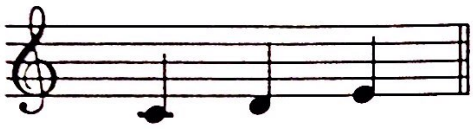

These notes move DOWN:

Do these notes move up or down?



_____

_____

56. The note on the first line of the treble staff is E. It is the next note in the music alphabet above D.

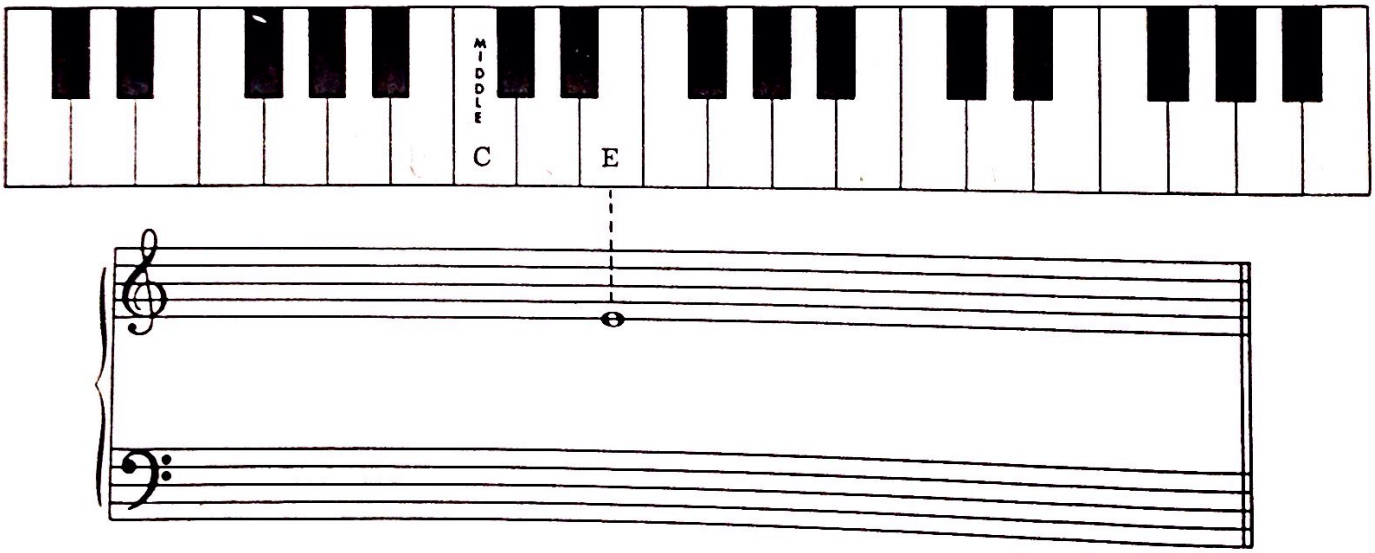

Write five E's on the first line of this treble staff. Use half notes.



Scanned by CamScanner