POST - Test
(Primer Level)

1. Write the names of the white keys under the keys marked X.

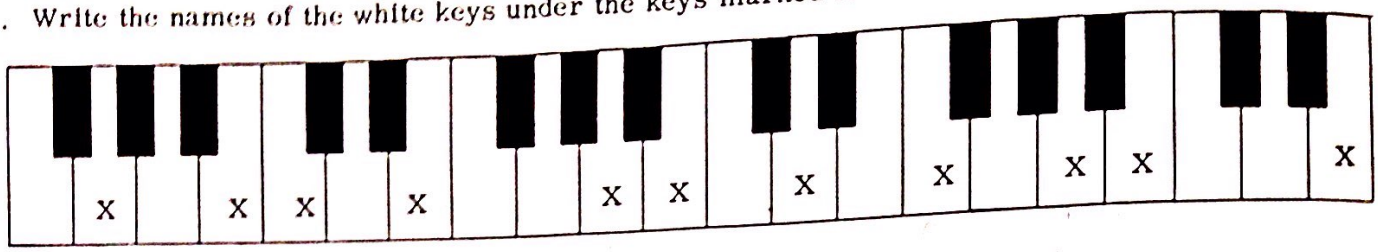

2. A music staff  has _____ lines and _____ spaces.

3. Does this music move up or down?

_____

_____

4. This 𝄞 is a _____ clef sign. This 𝄢 is a _____ clef sign.

   This ♩ is a _____ note. This 𝅗𝅥 is a _____ note.

   This 𝅗𝅥. is a _____ _____ note. This 𝅝 is a _____ note.

5. Explain this meter signature:

   4 – _____

   4 – _____

6. This 𝄾 is a _____ rest. This 𝄼 is a _____ rest.

   This 𝄿 is a _____ rest.

7. Under these notes and rests write how many beats each receives in $\frac{4}{4}$ meter.



_ _ _ _ _ _ _ _ _ _ _

8. Write the beats to the following measures of music.

9. Write the letter names under these notes.



_ _ _ _ _ _ _ _ _ _ _ _ _ _ _

10. This ♯ is a _____ sign. This ♭ is a _____ sign.

Scanned by CamScanner